Complete and Incomplete Circuits

Create the circuits in the pictures and test to see if they are complete (bulb will light) or incomplete (bulb will not light).

Circuit	Complete or Incomplete?
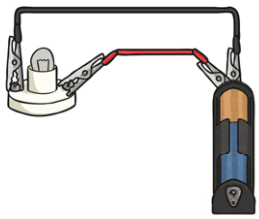	
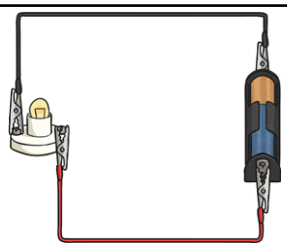	
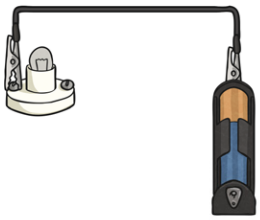	
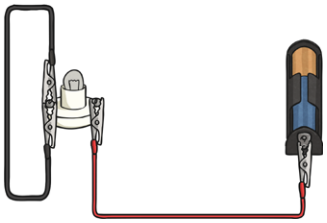	

What is the difference between the complete and incomplete circuits?